Cambridge Assessment International Education

Cambridge International AS & A Level

CANDIDATE NAME									
CENTRE NUMBER						CANDIDATE NUMBER			

4968591686

MATHEMATICS **9709/42**

Paper 4 Mechanics **October/November 2020**

1 hour 15 minutes

You must answer on the question paper.

You will need: List of formulae (MF19)

INSTRUCTIONS

- Answer **all** questions.
- Use a black or dark blue pen. You may use an HB pencil for any diagrams or graphs.
- Write your name, centre number and candidate number in the boxes at the top of the page.
- Write your answer to each question in the space provided.
- Do **not** use an erasable pen or correction fluid.
- Do **not** write on any bar codes.
- If additional space is needed, you should use the lined page at the end of this booklet; the question number or numbers must be clearly shown.
- You should use a calculator where appropriate.
- You must show all necessary working clearly; no marks will be given for unsupported answers from a calculator.
- Give non-exact numerical answers correct to 3 significant figures, or 1 decimal place for angles in degrees, unless a different level of accuracy is specified in the question.
- Where a numerical value for the acceleration due to gravity (g) is needed, use $10\,\text{m}\,\text{s}^{-2}$.

INFORMATION

- The total mark for this paper is 50.
- The number of marks for each question or part question is shown in brackets [ ].

Cambridge Math & Physics
cambridgemp.com

This document has **16** pages. Blank pages are indicated.

© UCLES 2020

BLANK PAGE

Kambridge Math & Physics
kambridgemp.com

1 Two particles P and Q, of masses 0.2 kg and 0.5 kg respectively, are at rest on a smooth horizontal plane. P is projected towards Q with speed $2\,\text{m s}^{-1}$.

(a) Write down the momentum of P. [1]

.....

.....

.....

.....

(b) After the collision P continues to move in the same direction with speed $0.3\,\text{m s}^{-1}$.

Find the speed of Q after the collision. [2]

.....

.....

.....

.....

.....

.....

.....

.....

.....

.....

.....

.....

.....

.....

.....

.....

Kambridge Math & Physics
kambridgemp.com

2 A car of mass 1800 kg is travelling along a straight horizontal road. The power of the car's engine is constant. There is a constant resistance to motion of 650 N.

(a) Find the power of the car's engine, given that the car's acceleration is $0.5\,\text{m s}^{-2}$ when its speed is $20\,\text{m s}^{-1}$. [3]

.....

.....

.....

.....

.....

.....

.....

.....

.....

.....

.....

.....

.....

Kambridge Math & Physics
kambridgemp.com

(b) Find the steady speed which the car can maintain with the engine working at this power. [2]

.....

.....

.....

.....

.....

.....

.....

.....

.....

.....

3

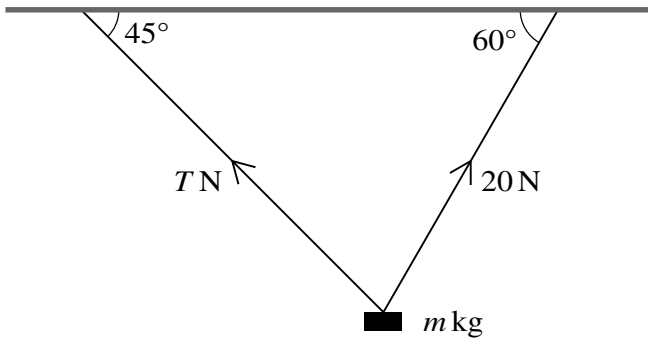

A block of mass m kg is held in equilibrium below a horizontal ceiling by two strings, as shown in the diagram. One of the strings is inclined at 45° to the horizontal and the tension in this string is T N. The other string is inclined at 60° to the horizontal and the tension in this string is 20 N.

Find T and m. [5]

Kambridge Math & Physics
kambridgemp.com

4

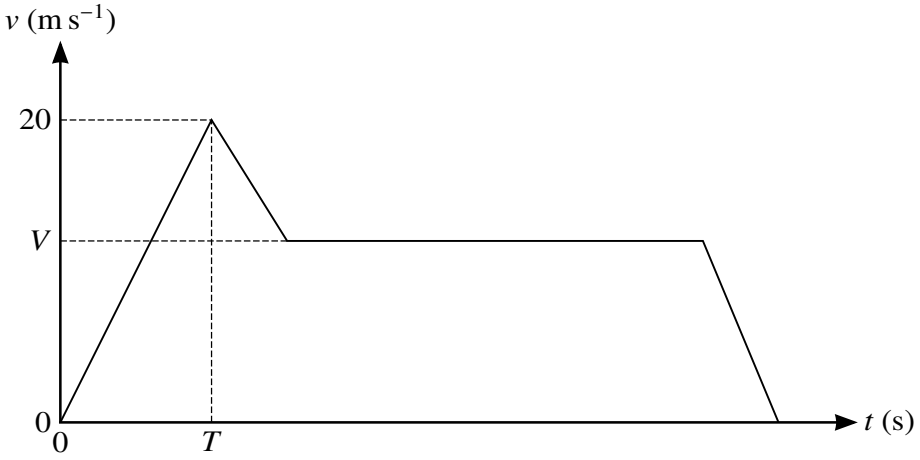

The diagram shows a velocity-time graph which models the motion of a car. The graph consists of four straight line segments. The car accelerates at a constant rate of $2\,m\,s^{-2}$ from rest to a speed of $20\,m\,s^{-1}$ over a period of T s. It then decelerates at a constant rate for 5 seconds before travelling at a constant speed of $V\,m\,s^{-1}$ for 27.5 s. The car then decelerates to rest at a constant rate over a period of 5 s.

(a) Find T. [1]

Kambridge Math & Physics
kambridgemp.com

(b) Given that the distance travelled up to the point at which the car begins to move with constant speed is one third of the total distance travelled, find V. [4]

Kambridge Math & Physics
kambridgemp.com

5 A particle is projected vertically upwards with speed $40\,\text{m}\,\text{s}^{-1}$ alongside a building of height h m.

(a) Given that the particle is above the level of the top of the building for 4 s, find h. [4]

Kambridge Math & Physics
kambridgemp.com

(b) One second after the first particle is projected, a second particle is projected vertically upwards from the top of the building with speed $20\,\text{m}\,\text{s}^{-1}$.

Denoting the time after projection of the first particle by t s, find the value of t for which the two particles are at the same height above the ground. [4]

Kambridge Math & Physics
kambridgemp.com

6 A block of mass 5 kg is placed on a plane inclined at 30° to the horizontal. The coefficient of friction between the block and the plane is μ.

(a)

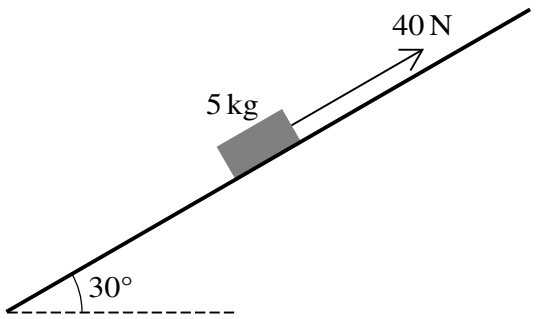

Fig. 6.1

When a force of magnitude 40 N is applied to the block, acting up the plane parallel to a line of greatest slope, the block begins to slide up the plane (see Fig. 6.1).

Show that $\mu < \frac{1}{5}\sqrt{3}$. [4]

.....

.....

.....

.....

.....

.....

.....

.....

.....

.....

.....

.....

.....

.....

.....

.....

Kambridge Math & Physics
kambridgemp.com

(b)

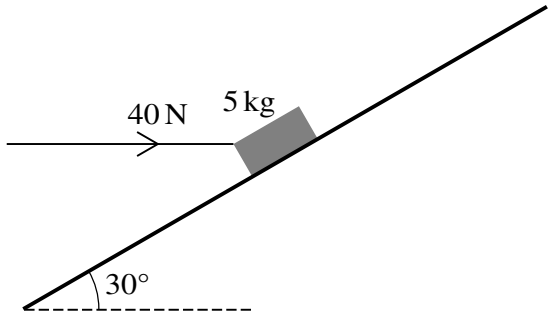

Fig. 6.2

When a force of magnitude 40 N is applied horizontally, in a vertical plane containing a line of greatest slope, the block does not move (see Fig. 6.2).

Show that, correct to 3 decimal places, the least possible value of μ is 0.152. [4]

Kambridge Math & Physics
kambridgemp.com

7 A particle P moves in a straight line, starting from a point O with velocity $1.72\,\text{m s}^{-1}$. The acceleration $a\,\text{m s}^{-2}$ of the particle, t s after leaving O, is given by $a = 0.1t^{\frac{3}{2}}$.

(a) Find the value of t when the velocity of P is $3\,\text{m s}^{-1}$. [4]

Kambridge Math & Physics
kambridgemp.com

(b) Find the displacement of P from O when $t = 2$, giving your answer correct to 2 decimal places. [3]

Kambridge Math & Physics
kambridgemp.com

8

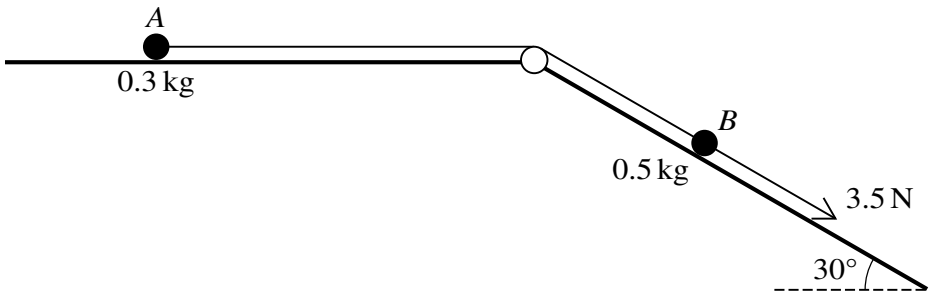

Two particles A and B, of masses 0.3 kg and 0.5 kg respectively, are attached to the ends of a light inextensible string. The string passes over a fixed smooth pulley which is attached to a horizontal plane and to the top of an inclined plane. The particles are initially at rest with A on the horizontal plane and B on the inclined plane, which makes an angle of 30° with the horizontal. The string is taut and B can move on a line of greatest slope of the inclined plane. A force of magnitude 3.5 N is applied to B acting down the plane (see diagram).

(a) Given that both planes are smooth, find the tension in the string and the acceleration of B. [5]

Kambridge Math & Physics
kambridgemp.com

(b) It is given instead that the two planes are rough. When each particle has moved a distance of 0.6 m from rest, the total amount of work done against friction is 1.1 J.

Use an energy method to find the speed of B when it has moved this distance down the plane. [You should assume that the string is sufficiently long so that A does not hit the pulley when it moves 0.6 m.] [4]

.....

.....

.....

.....

.....

.....

.....

.....

.....

.....

.....

.....

.....

.....

.....

.....

.....

.....

.....

.....

.....

.....

.....

Kambridge Math & Physics
kambridgemp.com

Additional Page

If you use the following lined page to complete the answer(s) to any question(s), the question number(s) must be clearly shown.

.....

.....

.....

.....

.....

.....

.....

.....

.....

.....

.....

.....

.....

.....

.....

.....

.....

.....

.....

Kambridge Math & Physics
kambridgemp.com

Permission to reproduce items where third-party owned material protected by copyright is included has been sought and cleared where possible. Every reasonable effort has been made by the publisher (UCLES) to trace copyright holders, but if any items requiring clearance have unwittingly been included, the publisher will be pleased to make amends at the earliest possible opportunity.

To avoid the issue of disclosure of answer-related information to candidates, all copyright acknowledgements are reproduced online in the Cambridge Assessment International Education Copyright Acknowledgements Booklet. This is produced for each series of examinations and is freely available to download at www.cambridgeinternational.org after the live examination series.

Cambridge Assessment International Education is part of the Cambridge Assessment Group. Cambridge Assessment is the brand name of the University of Cambridge Local Examinations Syndicate (UCLES), which itself is a department of the University of Cambridge.