Cambridge Assessment International Education

Cambridge International AS & A Level

CANDIDATE NAME

CENTRE NUMBER

CANDIDATE NUMBER

9016441563

MATHEMATICS **9709/41**

Paper 4 Mechanics **October/November 2025**

1 hour 15 minutes

You must answer on the question paper.

You will need: List of formulae (MF19)

Cambridge Math & Physics
cambridgemp.com

INSTRUCTIONS

- Answer **all** questions.
- Use a black or dark blue pen. You may use an HB pencil for any diagrams or graphs.
- Write your name, centre number and candidate number in the boxes at the top of the page.
- Write your answer to each question in the space provided.
- Do **not** use an erasable pen or correction fluid.
- Do **not** write on any bar codes.
- If additional space is needed, you should use the lined page at the end of this booklet; the question number or numbers must be clearly shown.
- You should use a calculator where appropriate.
- You must show all necessary working clearly; no marks will be given for unsupported answers from a calculator.
- Give non-exact numerical answers correct to 3 significant figures, or 1 decimal place for angles in degrees, unless a different level of accuracy is specified in the question.
- Where a numerical value for the acceleration due to gravity (g) is needed, use $10\,\text{m}\,\text{s}^{-2}$.

INFORMATION

- The total mark for this paper is 50.
- The number of marks for each question or part question is shown in brackets [ ].

This document has **12** pages.

© UCLES 2025

[Turn over

1 A car of mass 900 kg is moving along a straight horizontal road against a constant resistance to motion of 350 N. At an instant when the car is moving at $15\,m\,s^{-1}$ its acceleration is $0.25\,m\,s^{-2}$.

(a) Find the driving force of the car's engine at this instant. [2]

.....

.....

.....

.....

.....

.....

.....

.....

.....

(b) Find the power of the car's engine at this instant. [2]

.....

.....

.....

.....

.....

.....

.....

.....

.....

.....

.....

.....

.....

.....

.....

.....

.....

Kambridge Math & Physics
kambridgemp.com

DO NOT WRITE IN THIS MARGIN
DO NOT WRITE IN THIS MARGIN
DO NOT WRITE IN THIS MARGIN
DO NOT WRITE IN THIS MARGIN
DO NOT WRITE IN THIS MARGIN

DO NOT WRITE IN THIS MARGIN
DO NOT WRITE IN THIS MARGIN
DO NOT WRITE IN THIS MARGIN
DO NOT WRITE IN THIS MARGIN
DO NOT WRITE IN THIS MARGIN

2 Two particles, P and Q, of masses 3 kg and 5 kg respectively, are at rest on a smooth horizontal plane. P is projected at a speed of $4\,\text{m s}^{-1}$ directly towards Q. After P and Q collide, P has speed $1\,\text{m s}^{-1}$.

(a) Find the two possible speeds of Q after the collision. [3]

.....

.....

.....

.....

.....

.....

.....

.....

.....

.....

.....

.....

It is given that λ J of kinetic energy, where $\lambda > 0$, is lost during the collision.

(b) Find the value of λ. [2]

.....

.....

.....

.....

.....

.....

.....

.....

.....

.....

.....

.....

Kambridge Math & Physics
kambridgemp.com

3

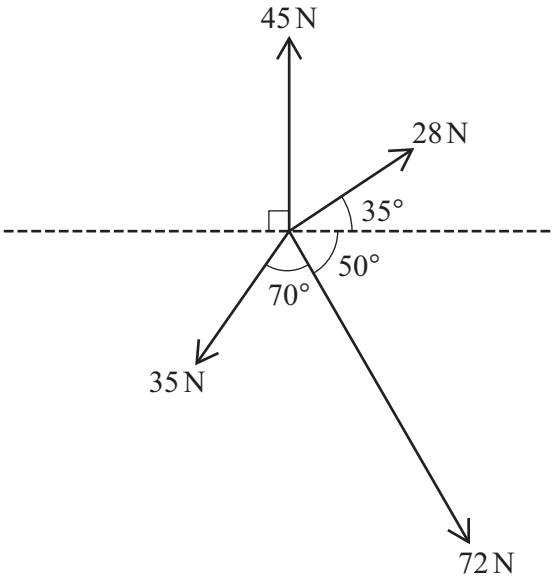

Coplanar forces of magnitudes 45 N, 28 N, 72 N and 35 N act at a point in the directions shown in the diagram.

Find, in either order, the magnitude and direction of the resultant force. [6]

Kambridge Math & Physics
kambridgemp.com

DO NOT WRITE IN THIS MARGIN

4

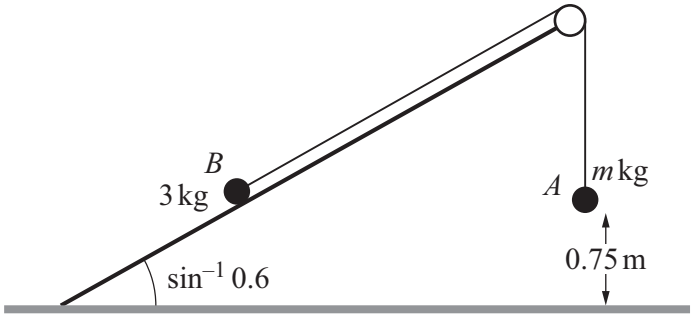

Two particles, A and B, of masses m kg and 3 kg respectively, are connected by a light inextensible string. Particle B is on a fixed plane which is at an angle of $\sin^{-1} 0.6$ to the horizontal ground. The string passes over a fixed smooth pulley at the top of the plane. Particle A hangs vertically below the pulley and is 0.75 m above the ground (see diagram).

The system is released from rest. In the subsequent motion B moves up a line of greatest slope of the plane and does not reach the pulley. As B moves up the plane there is a constant resistance to its motion of magnitude $\frac{10}{3}$ N. The speed of A immediately before it hits the ground is 2 m s^{-1}.

Use an energy method to find the value of m. [6]

Kambridge Math & Physics
kambridgemp.com

DO NOT WRITE IN THIS MARGIN

5

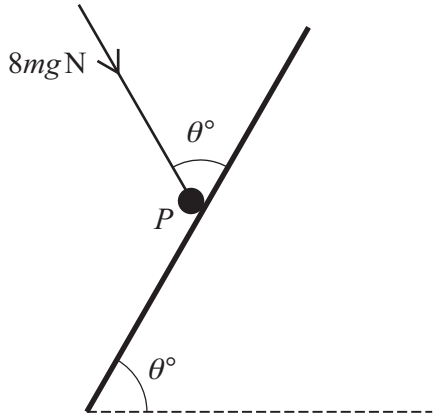

A particle P of mass m kg is in equilibrium on a rough plane inclined at an angle $\theta°$ to the horizontal. The equilibrium of P is maintained by a force of magnitude $8mg$ N making an angle $\theta°$ with a line of greatest slope (see diagram). The coefficient of friction between P and the plane is 0.5 and P is on the point of slipping down the plane.

Find the value of θ. [6]

Kambridge Math & Physics
kambridgemp.com

DO NOT WRITE IN THIS MARGIN

DO NOT WRITE IN THIS MARGIN
DO NOT WRITE IN THIS MARGIN
DO NOT WRITE IN THIS MARGIN
DO NOT WRITE IN THIS MARGIN
DO NOT WRITE IN THIS MARGIN

6 A particle A of mass 2.5 kg is released from rest from the top of a smooth plane, which makes an angle of $\sin^{-1} 0.2$ with the horizontal. The particle A collides 2 seconds later with a particle B, of mass 3 kg, which is moving up a line of greatest slope of the plane. The speed of B immediately before the collision is $3.5\,\text{m}\,\text{s}^{-1}$. Immediately after the collision, B has a velocity of $0.5\,\text{m}\,\text{s}^{-1}$ down the plane.

Find the distance A moves up the plane after the collision. [6]

Kambridge Math & Physics
kambridgemp.com

7 A particle P starts from a point O and moves in a straight line. The velocity $v\,\text{m}\,\text{s}^{-1}$ of P, at time t s after leaving O, is given by $v = \frac{1}{3}(2t-3)(t-4)$.

(a) Find the acceleration of P when $t = 2$. [2]

.....

.....

.....

.....

.....

.....

.....

.....

.....

.....

.....

(b) Find the total distance travelled by P in the first 3 seconds of its motion. [5]

.....

.....

.....

.....

.....

.....

.....

.....

.....

.....

.....

.....

.....

.....

Kambridge Math & Physics
kambridgemp.com

DO NOT WRITE IN THIS MARGIN
DO NOT WRITE IN THIS MARGIN
DO NOT WRITE IN THIS MARGIN
DO NOT WRITE IN THIS MARGIN
DO NOT WRITE IN THIS MARGIN

DO NOT WRITE IN THIS MARGIN
DO NOT WRITE IN THIS MARGIN
DO NOT WRITE IN THIS MARGIN
DO NOT WRITE IN THIS MARGIN
DO NOT WRITE IN THIS MARGIN

.....

.....

.....

.....

.....

.....

.....

.....

.....

(c) Determine whether P returns to O. [2]

.....

.....

.....

.....

.....

.....

.....

.....

.....

.....

.....

.....

.....

.....

.....

.....

.....

Kambridge Math & Physics
kambridgemp.com

8

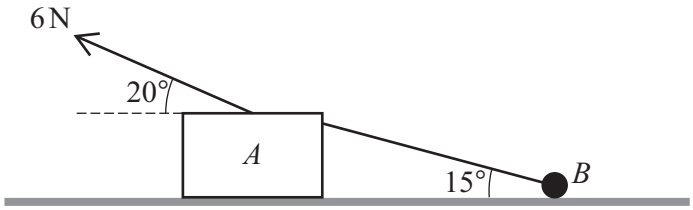

A block A of mass 2 kg and a particle B of mass 0.5 kg are connected by a light inextensible string inclined at 15° to the horizontal. They are pulled across a horizontal surface with acceleration $1.2\,\text{m s}^{-2}$ by a force of magnitude 6 N, applied to A, acting at 20° above the horizontal as shown in the diagram. The string and the force applied to A are in the same vertical plane.

The contact between B and the surface is smooth and the contact between A and the surface is rough.

(a) Find the tension in the string. [2]

Kambridge Math & Physics
kambridgemp.com

DO NOT WRITE IN THIS MARGIN

(b) Find the coefficient of friction between A and the surface. [6]

DO NOT WRITE IN THIS MARGIN
DO NOT WRITE IN THIS MARGIN
DO NOT WRITE IN THIS MARGIN
DO NOT WRITE IN THIS MARGIN
DO NOT WRITE IN THIS MARGIN

Kambridge Math & Physics
kambridgemp.com

Additional page

If you use the following page to complete the answer to any question, the question number must be clearly shown.

Kambridge Math & Physics
kambridgemp.com

DO NOT WRITE IN THIS MARGIN
DO NOT WRITE IN THIS MARGIN
DO NOT WRITE IN THIS MARGIN
DO NOT WRITE IN THIS MARGIN
DO NOT WRITE IN THIS MARGIN

Permission to reproduce items where third-party owned material protected by copyright is included has been sought and cleared where possible. Every reasonable effort has been made by the publisher (UCLES) to trace copyright holders, but if any items requiring clearance have unwittingly been included, the publisher will be pleased to make amends at the earliest possible opportunity.

To avoid the issue of disclosure of answer-related information to candidates, all copyright acknowledgements are reproduced online in the Cambridge Assessment International Education Copyright Acknowledgements Booklet. This is produced for each series of examinations and is freely available to download at www.cambridgeinternational.org after the live examination series.

Cambridge Assessment International Education is part of Cambridge Assessment. Cambridge Assessment is the brand name of the University of Cambridge Local Examinations Syndicate (UCLES), which is a department of the University of Cambridge.